T٠٤_S٠٣

مثال دعونا نرسم ○ حول الرقم الصحيح الذي يمثل عدد البصل.

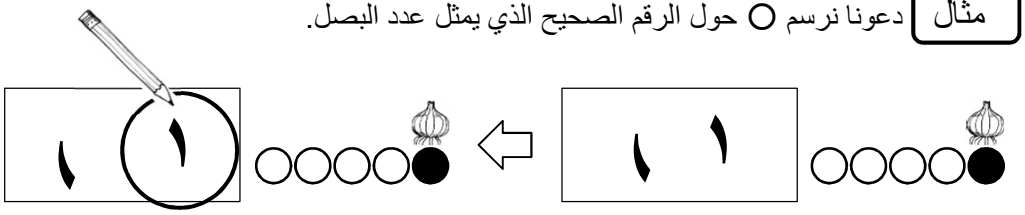

جيد!

السؤال دعونا نرسم ○ حول الرقم الصحيح الذي يمثل عدد البصل.

(١)



٢ ٨

(٢)

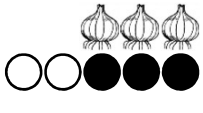

٣ ٨

(٣)

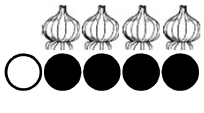

٤ ٦

(٤)

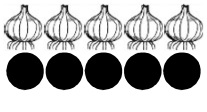

٥ ٥

السؤال دعونا نرسم ○ حول الرقم الصحيح الذي يمثل عدد البصل.

(١)

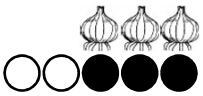

٢ ٣ ٨ ٨ ٥

(٢)

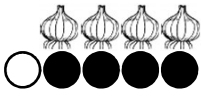

٦ ٢ ٤ ٣ ٥

(٣)

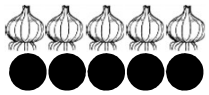

٥ ١ ٣ ٥ ٤