مثال دعونا نرسم ○ حول الرقم الصحيح الذي يمثل عدد البصل.

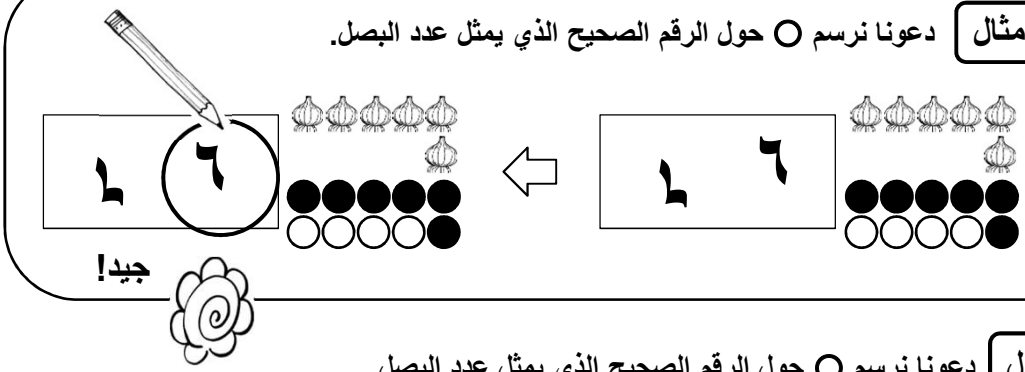

السؤال دعونا نرسم ○ حول الرقم الصحيح الذي يمثل عدد البصل.

(١)

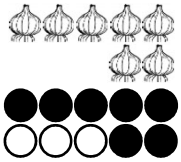

٧ ٢

(٢)

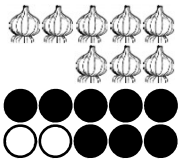

٨ ٤

(٣)

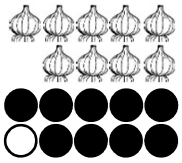

٩ ٥

(٤)



١ ١

السؤال دعونا نرسم ○ حول الرقم الصحيح الذي يمثل عدد البصل.

(١)

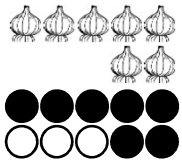

٣ ٤ ٧ ٨ ٢

(٢)

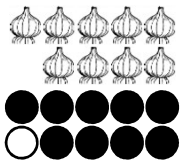

٨ ٩ ٦ ٥ ٧

(٣)



١ ٩ ٧ ٦ ١